Nets of Solids

Bands 1, 2, 3, 4, 5 · 10 questions · Free sample

Name _____ Date _____ Score _____ / 10

Each picture asks its own question. A net folds up with the printed side outside; dashed lines on a solid are edges at the back. Circle the letter of your answer.

★ Love puzzles? Practise online for free at aztest.org — new questions every time!

1 Band 1

Which solid does this net fold into?

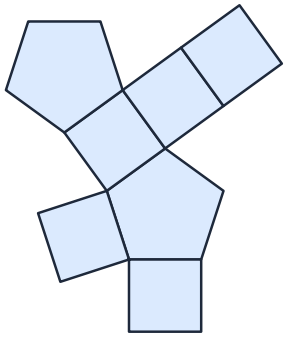

A

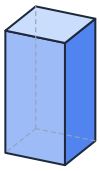

B

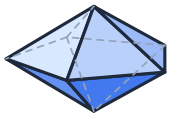

C

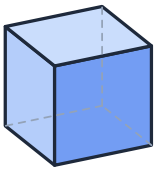

D

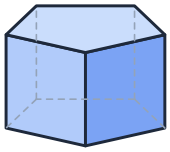

2 Band 1

Which solid does this net fold into?

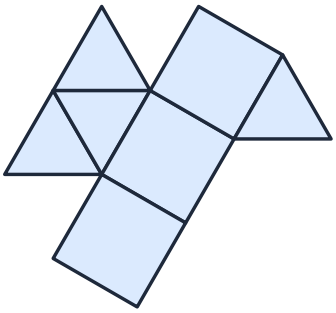

A



B

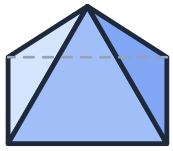

C

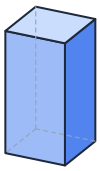

D

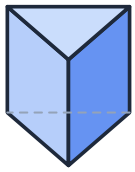

3 Band 2

Which pattern is a net of this solid?

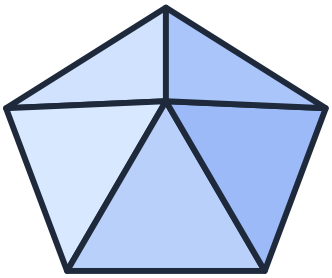

A

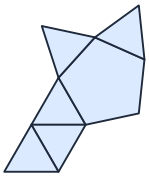

B

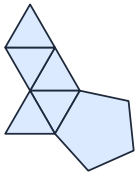

C

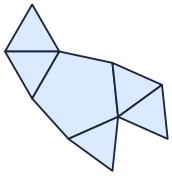

D

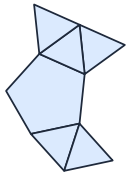

4 Band 2

Which pattern is a net of this solid?

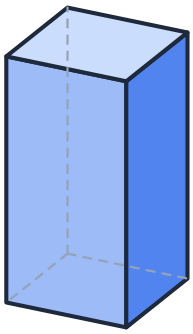

A

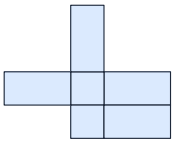

B

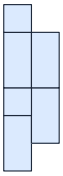

C

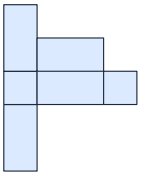

D

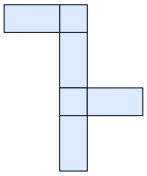

5 Band 3

Which pattern is a net of this solid?



A

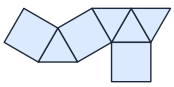

B

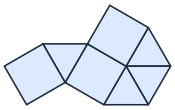

C

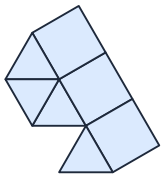

D

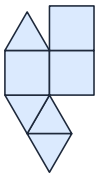

6 Band 3

Which pattern is a net of this solid?

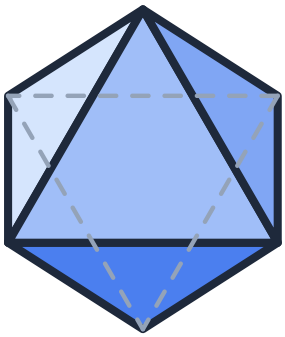

A

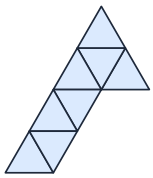

B

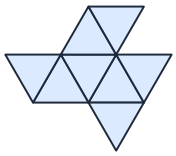

C

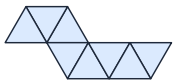

D



7 Band 4

The net folds with its colours outside. Which coloured solid does it make?

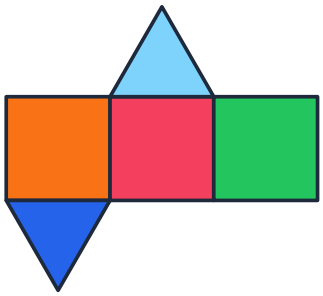

A



B



C



D



8 Band 4

The net folds with its colours outside. Which coloured solid does it make?



A



B



C



D



9 Band 5

The net folds with its colours outside. Which coloured solid does it make?

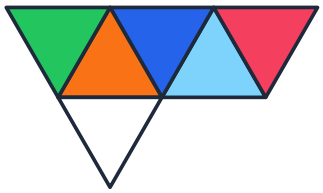

A



B



C



D



10 Band 5

The net folds with its colours outside. Which coloured solid does it make?

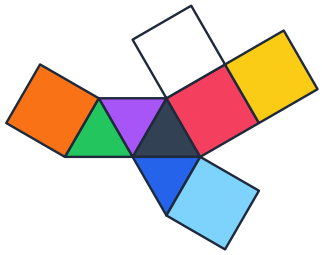

A



B



C



D

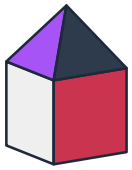

Enjoyed these puzzles? There's so much more waiting for you online!

Visit aztest.org for unlimited practice that adapts to your level, timed IQ tests with instant results, and Puzzle Rooms where you can race your friends or your whole class on a live leaderboard. It's free, and you can start playing in seconds.

Come and play at aztest.org →

aztest.org — free puzzles & practice tests

Make your own at aztest.org/worksheets